# ベクトル

日付(　　月　　日　　曜日　)
名前 (　　)

## ベクトルの加法

$\overrightarrow{AB} + \overrightarrow{BC} = \overrightarrow{AC}$

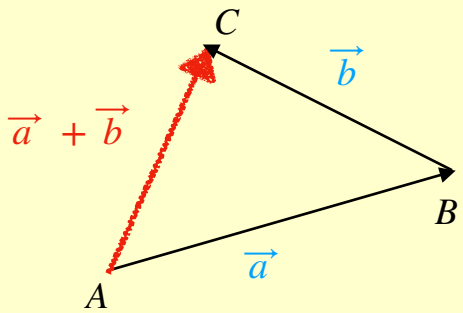


**例**　平行四辺形を使ったベクトルの和

$\overrightarrow{AB} + \overrightarrow{AD} =$ ? ? ?

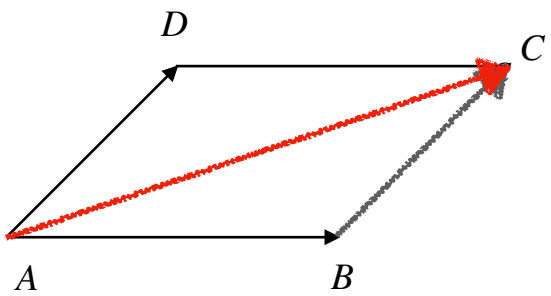


$\overrightarrow{AB} + \overrightarrow{AD}$

$= \overrightarrow{AB} + \overrightarrow{BC}$

$= \overrightarrow{AC}$

## ベクトルの加法の性質

・ $\vec{a} + \vec{b} = \vec{b} + \vec{a}$

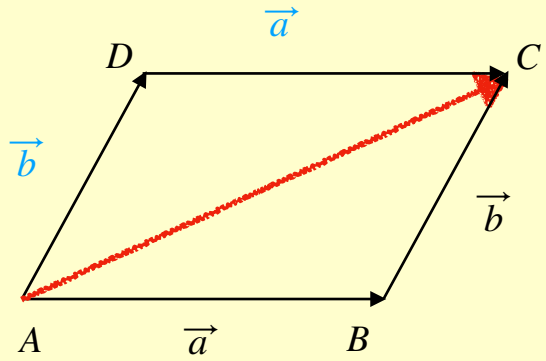

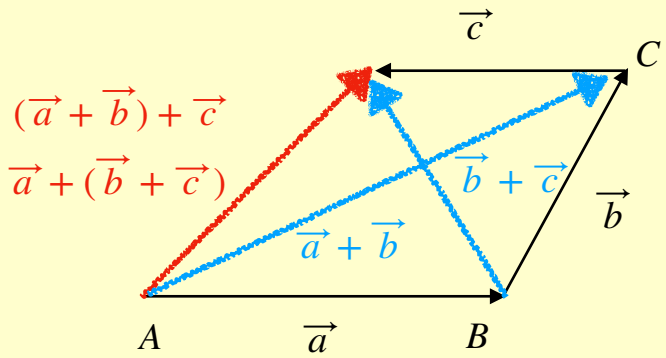
・ $(\vec{a} + \vec{b}) + \vec{c} = \vec{a} + (\vec{b} + \vec{c})$